Name: _____ Date: _____

Division Picture Problems with Arrays

Look at each array or group of objects.
Write a division sentence to match the picture. Then answer the question.

1. There are 24 circles in an array.
They are in 6 equal rows.



Write a division sentence:

_____

How many in each row? _____

2. There are 36 stars in an array.
They are in 4 equal rows.

Write a division sentence:

_____

How many in each row? _____

3. There are 30 cupcakes.
They are shared equally into 5 groups.



Write a division sentence:

_____

How many in each group? _____

4. There are 42 apples.
They are shared equally into 6 groups.



Write a division sentence:

_____

How many in each group? _____

5. There are 48 buttons in an array.
They are in 8 equal rows.



Write a division sentence:

_____

How many in each row? _____

6. There are 27 pencils.
They are shared equally into 3 groups.

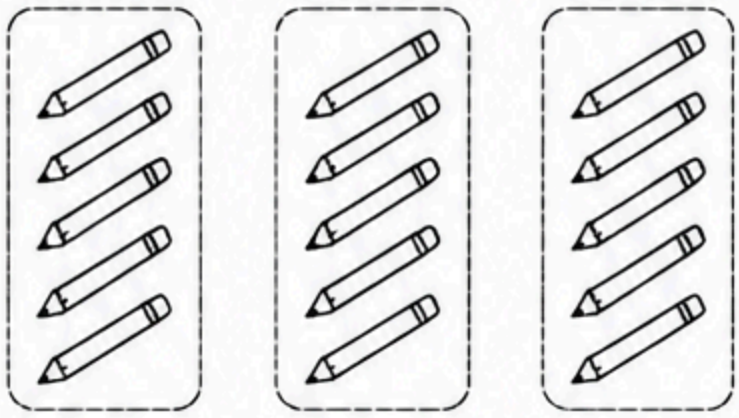

Write a division sentence:

_____

How many in each group? _____