Name: _____ Date: _____

Picture Subtraction with Crossing Out

Cross out (take away) the number of objects shown.
How many are left? Write your answer in the box.

1.

42 – 17 = ☐

2.

36 – 14 = ☐

3.

48 – 26 = ☐

4.

64 – 37 = ☐

5. 

50 – 16 = ☐

6. 

68 – 29 = ☐

7. 

55 – 23 = ☐

8. 

42 – 18 = ☐

9.

60 – 28 = ☐

10. 

72 – 34 = ☐

Cross out carefully. Count what is left. Then write your answer.