Name: _____ Date: _____

Picture Array Multiplication Problems

Count the objects in each array. Write a multiplication equation to match.
Use the format: number of rows × number of columns = total.

1.

☐ × ☐ = ☐

2.



☐ × ☐ = ☐

3.



☐ × ☐ = ☐

4.

☐ × ☐ = ☐

5.



☐ × ☐ = ☐

6.



☐ × ☐ = ☐