Name: _____ Date: _____

Shade the Fraction - Visual Models

Shade the shapes to show the fraction given.

1. $\frac{1}{2}$

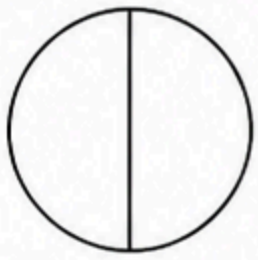

2. $\frac{1}{4}$



3. $\frac{3}{4}$

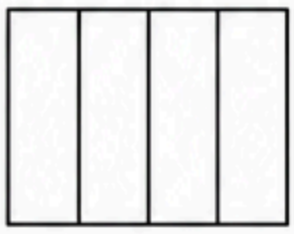

4. $\frac{2}{3}$

5. $\frac{3}{5}$

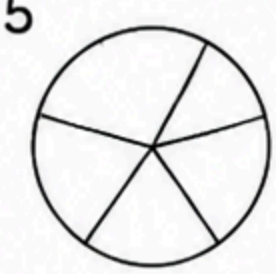

6. $\frac{1}{2}$



7. $\frac{1}{4}$

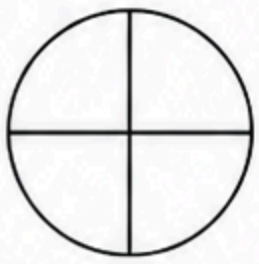

8. $\frac{3}{4}$

9. $\frac{2}{3}$

10. $\frac{3}{5}$

11. $\frac{1}{2}$

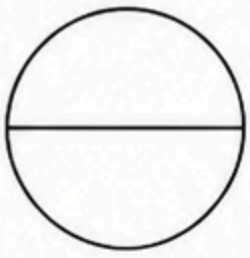

12. $\frac{1}{4}$



13. $\frac{3}{4}$



14. $\frac{2}{3}$

15. $\frac{3}{5}$

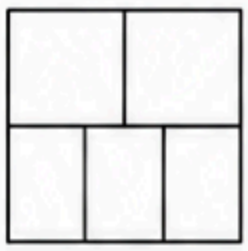

16. $\frac{1}{2}$



17. $\frac{1}{4}$

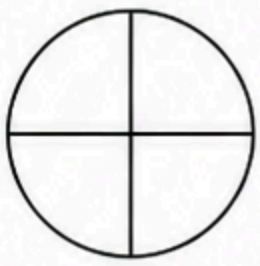

18. $\frac{3}{4}$



19. $\frac{2}{3}$

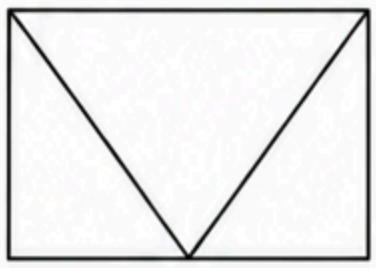

20. $\frac{3}{5}$

Challenge: Draw your own shape below and shade it to show the fraction given.

a) $\frac{1}{2}$

b) $\frac{3}{4}$

c) $\frac{2}{3}$